All rights reserved. No part of this publication may be reproduced, distributed, or transmitted in any form or by any means, electronic, mechanical, photocopying, recording or otherwise, or stored in any retrieval system of any nature without the permission of cracku.in, application for which shall be made to support@cracku.in

Downloaded from cracku.in

SSC CHSL 10th August 2021 Shift-3

English Language

1. **Select the most appropriate meaning of the given idiom.**
   Break the ice

A Make a beginning or start something

B Cool the room for everyone

C Arrange for a skating show

D Make things available for a party

Answer: A

2. **Select the most appropriate option to substitute the underlined segment in the given sentence. If there is no need to substitute it, select 'No substitution required'.**
   <u>Regard of whether</u> the students were ready or not the teacher announced the dates of the test.

A Regarding whether

B Regardless of whatsoever

C No substitution required

D Regardless of whether

Answer: D

3. **Select the most appropriate synonym of the given word.**
   Silt

A Cut

B Opening

C Residue

D Incision

Answer: C

4. **Select the INCORRECTLY spelt word.**

A Suceed

B Inherit

C Implant

D Accede

Answer: A

SSC CHSL Free Mock Test

Downloaded from cracku.in

5. **Select the option that can be used as a one-word substitute for the given group of words.**
The arrangement of events or dates in the order of their occurrence.

A Calendar

B Chronology

C Chronic

D Routine

Answer: B

6. **Select the most appropriate synonym of the given word.**
Vacillate

A Augment

B Waver

C Strengthen

D Fortify

Answer: B

7. **Sentences of a paragraph are given below in jumbled order. Arrange the sentences in the right order to form a meaningful and coherent paragraph.**
A. The country gained admission to the United Nations in 1955.
B. In 2008, however, after a decade long period of violence and turbulent negotiation with a strong Maoist insurgency, the monarchy was dissolved, and Nepal was declared a democratic republic.
C. In 1991 the kingdom established a multiparty parliamentary system.
D. Nepal, long under the rule of hereditary prime ministers favouring a policy of isolation, remained closed to the outside world until a palace revolt in 1950 restored the crown's authority in 1951.

A BCDA

B DACB

C DBAC

D CABD

Answer: B

SSC CHSL Prevoius Papers (DOWNLOAD PDF)

8. **The following sentence has been divided into parts. One of them may contain an error. Select the part that contains the error from the given options. If you don't find any error, mark 'No error' as your answer.**
Vidya put on her mask, / sanitise her hands / and walked into the shop.

A and walked into the shop

B No error

C Vidya put on her mask

D sanitise her hands

Answer: D

Downloaded from cracku.in

9. **Select the most appropriate ANTONYM of the given word.**
Rigid

A Definite

B Flexible

C Adamant

D Firm

Answer: B

10. **Select the option that expresses the given sentence in passive voice.**
Ravi drove the car towards the highway for a trial run.

A The car was driving towards the highway for a trial run by Ravi.

B The car had driven towards the highway for a trial run by Ravi.

C The car had been driven for a trial run by Ravi towards the highway.

D The car was driven towards the highway for a trial run by Ravi.

Answer: D

SSC CGL Previous Papers (DOWNLOAD PDF)

11. **Sentences of a paragraph are given below in jumbled order. Arrange the sentences in the right order to form a meaningful and coherent paragraph.**
A. First, a new article comes into our offices.
B. Every article in the Encyclopedia goes through a rigorous editorial process to make sure it's clear, accurate, objective and fair.
C. The article is first reviewed by a fact checker, who uses a variety of sources to make sure the article is accurate and the facts are correct.
D. The author may be an editor at the Encyclopedia who knows that subject or a prominent scholar with specialised expertise in that field.

A BADC

B BCAD

C CDAB

D CADB

Answer: A

12. **Select the most appropriate word to fill in the blank.**
As the Principal was busy, she _____ a senior teacher to attend the conference on her behalf.

A Reserved

B Declared

C Deputed

D Committed

Answer: C

Downloaded from cracku.in

13. **Select the most appropriate option to substitute the underlined segment in the given sentence. If there is no need to substitute it, select 'No substitution required'.**
If a person tests positive for Covid-19, he have to isolate himself immediately so that he does not infect others.

A he must have to isolate

B he isolated himself

C he has to isolate himself

D No substitution required

Answer: C

SSC CGL Free Mock Test (Latest Pattern)

14. **Select the option that expresses the given sentence in direct speech.**
The customer asked the bank manager if they were working on the following Saturday.

A The customer asked the bank manager, "Are they working on the previous Saturday?"

B The customer said to the bank manager, "Are you working next Saturday?"

C The customer asks the bank manager, "If you were working on the following Saturday?"

D The customer said to the bank manager, "Were they working on the previous Saturday?"

Answer: B

15. **Select the INCORRECTLY spelt word.**

A Preshious

B Plenary

C Presentable

D Peaceful

Answer: A

16. **The following sentence has been divided into parts. One of them may contain an error. Select the part that contains the error from the given options. If you don't find any error, mark 'No error' as your answer.**
Your advices were timely / and guided me / to take the right decisions.

A to take the right decisions

B No error

C and guided me

D Your advices were timely

Answer: D

SSC CHSL Important Questions and Answers (Download PDF)

17. **Select the most appropriate ANTONYM of the given word.**
Inept

Downloaded from cracku.in

A Partial

B Lacking

C Competent

D Useless

Answer: C

18. **Select the most appropriate meaning of the given idiom.**
A lean patch

A Cloth that is beginning to tear

B A part of hair that is thin

C Friendship that has ended

D A period of poor performance

Answer: D

19. **Select the option that can be used as a one-word substitute for the given group of words.**
A place of ideal perfection especially in laws, government, and social conditions

A Paradise

B Heaven

C Utopia

D Aden

Answer: C

SSC CHSL Study Material

20. **Select the most appropriate word to fill in the blank.**
Carbohydrates are so called because they _____ carbon, oxygen and hydrogen.

A contain

B cover

C consist

D codify

Answer: A

Instructions [21 - 25]

In the following passage, some words have been deleted. Select the most appropriate option to fill in each blank.

Comprehension:
Seychelles, one of the world's smallest countries, is (1)_____ of two main island groups: the Mahé group of (2)_____ than 40 central, mountainous granitic islands and a (3)_____ group of more than 70 outer, flat, coralline islands. The islands of the Mahé group are rocky and (4)_____ have a narrow coastal strip and a central range of hills. The (5)_____ feature of those islands, with their lush tropical vegetation, is that of high hanging gardens overlooking silver-white beaches and clear lagoons.

Downloaded from cracku.in

21. **Select the most appropriate option to fill in blank no. 1.**

A Covered

B Composed

C Contained

D Combined

Answer: B

22. **Select the most appropriate option to fill in blank no. 2.**

A Further

B Beyond

C Extra

D More

Answer: D

SSC CHSL Free App

23. **Select the most appropriate option to fill in blank no. 3.**

A Succeeding

B Next

C Second

D Subsequent

Answer: C

24. **Select the most appropriate option to fill in blank no. 4.**

A Typically

B Routinelly

C Regularly

D Habitually

Answer: A

25. **Select the most appropriate option to fill in blank no. 5.**

A Collective

B Wide

C Predominant

D Global

Answer: C

Downloaded from cracku.in

Daily Free SSC Practice Set

General Intelligence

26. **Select the number from among the given options that can replace the question mark (?) in the following series.**
8, 11, 17, 26, 38, ?

A 53

B 56

C 50

D 58

Answer: A

Free SSC Study Material (18,000 Solved Questions)

27. **Select the option in which the numbers share the same relationship as that shared by the given pair of numbers.**
56 : 67

A 49:58

B 85:98

C 76:88

D 63:75

Answer: B

28. **Train A, which runs at a speed of 90 km/h, starts from Station Y at 8 a.m. Train B, which runs at a speed of 120 km/h, starts from Station Y on the same route at 8.10 a.m.. If Train B catches up with Train A at 8.40 a.m. at Station Z, then what is the distance between Stations Y and Z?**

A 54 km

B 62 km

C 60 km

D 50 km

Answer: C

29. **Sunaina introduced Ritik as the son of the brother of her mother. How is Ritik related to Sunaina?**

A Son

B Cousin

C Uncle

D Nephew

Answer: B

Downloaded from cracku.in

30. **Select the option that is embedded in the given figure (rotation is NOT allowed).**

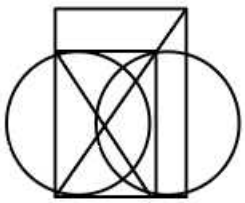

A

B

C 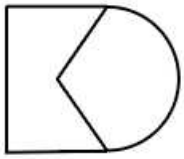

D 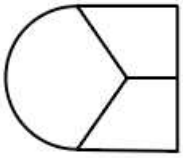

Answer: C

31. **How many cubes are there in the given figure?**

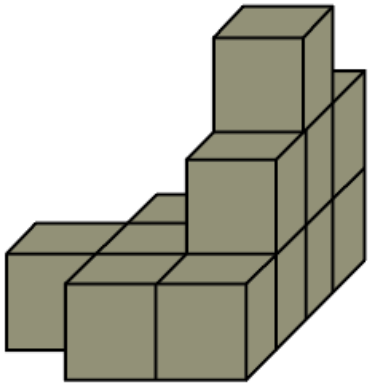

A 13

B 11

C 12

D 14

Answer: C

Downloaded from cracku.in

32. **In a certain code language, TOGETHER is coded as 119 and MASTER is coded as 87. How will REVERSE be coded in that language?**

A 92

B 98

C 94

D 96

Answer: B

SSC Exam Update Videos & Free Study Material (YouTube Channel)

33. **Four letter-clusters have been given in the options, out of which three letter-clusters are alike in some manner and one is different. Select the letter-cluster that is different.**

A GDBY

B UROL

C QNKH

D JGDA

Answer: A

34. **In a certain code language, TRAILER is written as QPXGICO. How will ALMIRAH be written in that language?**

A XIJFOXE

B YJKGPYF

C YIKFPXF

D XJJGOYE

Answer: D

35. **Select the option in which the numbers are related in the same way as are the numbers of the following set.**
32 : 63 : 123

A 26 : 48 : 92

B 26 : 51 : 100

C 35 : 72 : 149

D 33 : 66 : 130

Answer: A

Latest Job Updates on Telegram - Join here

36. **Select the option that is related to the third word in the same way as the second word is related to the first word.**
Hollow : Worthless : : Solid : ?

Downloaded from cracku.in

A Sound

B Sincere

C Acceptance

D Clear

Answer: A

37. **Select the Venn diagram that bestrepresents the relationship between the following classes.**
Carnivorous, Frog, Amphibian

A 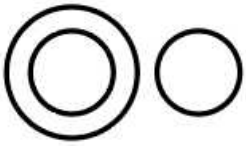

B

C 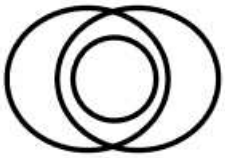

D 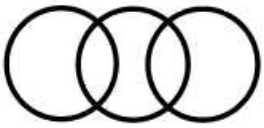

Answer: C

38. **Four words have been given, out of which three are alike in some manner and one is different. Select the word that is different.**

A Confident

B Intelligent

C Coward

D Honest

Answer: C

Join SSC Daily Quiz Telegram Group

39. **Select the figure from among the given options that can replace the question mark (?) in the following series.**

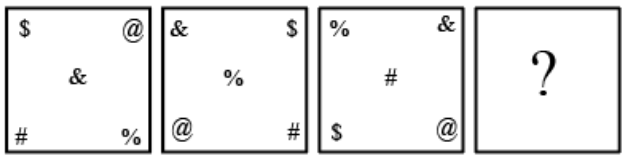

Downloaded from cracku.in

A

B

C 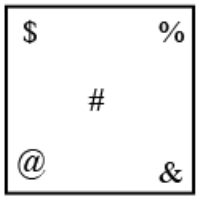

D

Answer: D

40. **Three different positions of the same dice are shown. Select the number that will be on the face opposite to the face having the number 4.**

A 6

B 1

C 3

D 2

Answer: B

41. **Read the given statements and conclusions carefully. Assuming that the information given in the statements is true, even if it appears to be at variance with commonly known facts,**
decide which of the given conclusions logically follow(s) from the statements.
Statements:
All bats are sticks.
All sticks are woods.
Conclusions:
I. Some woods are not bats.
II. All bats are woods.

A Both conclusions I and II follow.

B Neither conclusion I nor II follows.

Downloaded from cracku.in

C Only conclusion II follows.

D Only conclusion I follows.

Answer: C

42. **The sequence of folding a piece of paper and the manner in which the folded paper has been cut is shown in the following figures. How would this paper look when unfolded?**

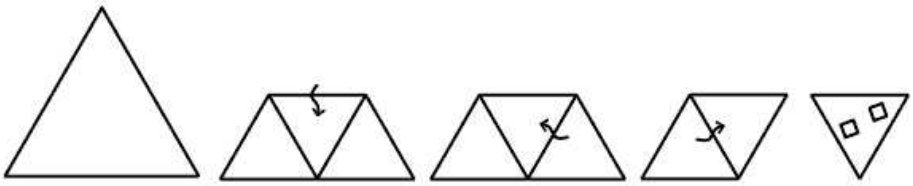

A 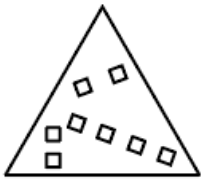

B 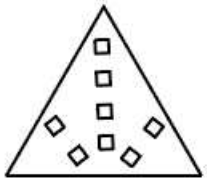

C 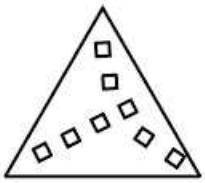

D 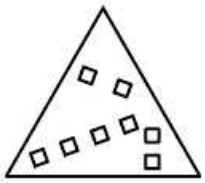

Answer: D

43. **Select the correct mirror image of the given figure when the mirror is placed at the right side.**

A

Downloaded from cracku.in

B

C

D

Answer: B

44. **Select the option that is related to the third word in the same way as the second word is related to the first word.**
Sacred : Profane : : Barren : ?

A Fertile

B Desert

C Empty

D Sterile

Answer: A

SSC CHSL Free Mock Test

45. **Select the correct option that indicates the arrangement of the given words in a logical and meaningful order.**
1. Beam
2. Canopy
3. Foundation
4. Roof
5. Column

A 3-2-1-5-4

B 3-5-1-4-2

C 1-2-5-3-4

D 5-3-1-2-4

Answer: B

46. **Which two digits and two signs need to be interchanged so as to balance the given equation?**
$98 \div 4 - 126 + 96 \times 5 = 266$

A 8 and 2; − and +

Downloaded from cracku.in

B 5 and 8; × and ÷

C 5 and 9; + and ÷

D 6 and 4; × and ÷

Answer: B

47. **Select the option that is related to the third term in the same way as the second term is related to the first term.**
COMPETE : OCETPME : : EXTREME : ?

A EMXEERT

B RTXEEME

C XEEMRTE

D XERTMEE

Answer: C

SSC CHSL Prevoius Papers (DOWNLOAD PDF)

48. **Select the option in which the numbers are related in the same way as are the numbers of the following set.**
(92, 85, 82)

A (28, 23, 21)

B (71, 65, 62)

C (83, 78, 77)

D (69, 66, 62)

Answer: C

49. **Four numbers have been given, out of which three are alike in some manner and one is different. Select the number that is different.**

A 199

B 139

C 183

D 163

Answer: C

50. **Select the combination of letters that when sequentially placed in the blanks of the given series will complete the series.**
t _ f e t c _ _ _ c f e

A t c f e

B f e t c

C e c f t

D c f e t

Downloaded from cracku.in

Answer: D

SSC CGL Previous Papers (DOWNLOAD PDF)

Quantitative Aptitude

51. **Some families went on an outstation tour. The given histogram shows their ages.**
What is the ratio of the number of persons of age less than 15 years to that of persons of age less than 30 years?

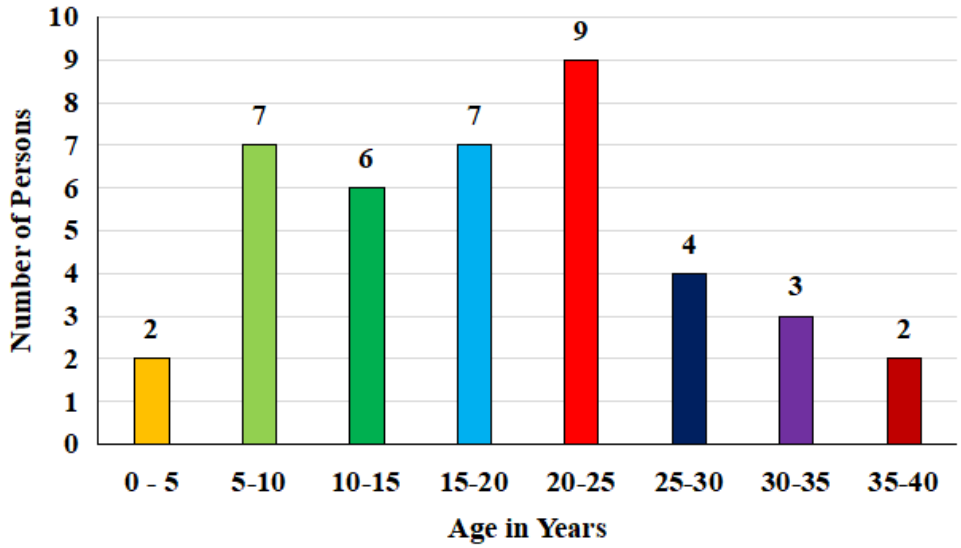

A 15 : 38

B 15 : 31

C 3 : 7

D 11 : 19

Answer: C

SSC CGL Free Mock Test (Latest Pattern)

52. **When the price of an item was reduced by 20%, its sales increased by x% . If there is an increase of 25% in the receipt of the revenue, then the value of x is:**

A 53.84%

B 55.75%

C 56.25%

D 61.5%

Answer: C

53. **In a trapezium ABCD , DC ∥ AB, AB = 16cm and DC = 11.2 cm. Whatis the length (in cm) of the line segment joining the mid points of its diagonals?**

A 2.4

Downloaded from cracku.in

B 1.8

C 1.2

D 2.8

Answer: A

54. **In a class of 80 students (boys and girls) there are 60% girls. The average weight of the boys is 58 kg and that of the girls is 52 kg. What is the average weight(in kg) of the whole class?**

A 56.2

B 54.4

C 53.6

D 55

Answer: B

SSC CHSL Important Questions and Answers (Download PDF)

55. $\frac{775\times775\times775+225\times225\times225}{77.5\times77.5+22.5\times22.5-77.5\times22.5}$ **is equal to:**

A 100

B 10000

C 100000

D 0.1

Answer: C

56. **Study the bar graph which shows the imports and exports (in ₹) of steel of a country during 2013 to 2017 and answer the question that follows.**

For how many year(s) were the imports less than 80%ofthe average exports (per year) of the country during the five years?

Downloaded from cracku.in

A 4

B 1

C 3

D 2

Answer: D

57. **If $a+b+c=5, a^2+b^2+c^2=27$, and $a^3+b^3+c^3=125$, then the value of $\frac{abc}{5}$ is:**

A -1

B 5

C -5

D 1

Answer: A

SSC CHSL Study Material

58. **A sum lent at simple interest amounts to ₹6,240.80 in one year and to ₹7,563.20 in 4 years. The sum (in ₹) and the rate of interest per annum, respectively, are:**

A 6,200, 8.5%

B 5,800, 8.5%

C 5,800, 7.6%

D 6,200, 7.6%

Answer: C

59. **If the 11-digit number 4v6884805x6 is divisible by 72, and $x \neq y$, then the value of $\sqrt{xy}$ is:**

A $\sqrt{12}$

B $\sqrt{6}$

C $\sqrt{5}$

D $\sqrt{8}$

Answer: B

60. **In $\triangle PQR, QT \perp PR$ and S is a point on QR such that $\angle PSQ = p^\circ$. If $\angle TQR = 44^\circ$ and $\angle SPR = 32^\circ$, then the value of p is:**

A 72°

B 82°

C 76°

Downloaded from cracku.in

D 78°

Answer: D

SSC CHSL Free App

61. **Two circles of radii 18 cm and 12 cm intersect each other and the length of their common chord is 16 cm. What is the distance (in cm) between their centres?**

A $2\sqrt{5}(2+\sqrt{13})$

B $2\sqrt{5}(4-\sqrt{13})$

C $2\sqrt{5}(4+\sqrt{13})$

D $2\sqrt{5}(-2+\sqrt{13})$

Answer: A

62. **The value of** $\cot^2 46^\circ - \sec^2 44^\circ + (\sin^2 1^\circ + \sin^2 3^\circ + \sin^2 5^\circ + ... + \sin^2 89^\circ)$ **is:**

A 23.5

B 20.5

C 22.5

D 21.5

Answer: D

63. **If** $(1+\cot^2\theta)+(1+(\cot^2\theta)^{-1})$ **is equal to k, then** $\sqrt{k}=?$

A $\sin\theta\sec\theta$

B $\operatorname{cosec}\theta\cos\theta$

C $\operatorname{cosec}\theta\sec\theta$

D $\sin\theta\cos\theta$

Answer: C

Daily Free SSC Practice Set

64. **The sides AB, BC and AC of** $\triangle ABC$ **are 12 cm, 8 cm and 10 cm, respectively. A circle is inscribed in the triangle touching AB, BC and AC at D, E and F, respectively. The ratio of the lengths of AD to CE is:**

A 5 : 7

B 3 : 5

C 10 : 7

D 7 : 3

Answer: D

Downloaded from cracku.in

65. By selling a car for ₹6,32,500, a showroom owner makesa profit of 15%. If he sold the car at ₹8,10,000, then what would be the profit percentage (correct to one decimal place)?

A 47.3%

B 44.8%

C 41.5%

D 51.4%

Answer: A

66. If $(x-1.5)^3+(x-4)^3+(x-3.5)^3=3(x-1.5)(x-4)(x-3.5)$, then what is the value of x ?

A 1

B 3

C 6

D 9

Answer: B

Free SSC Study Material (18,000 Solved Questions)

67. Study the pie chart and answer the question that follows.
The given pie chart shows the degree of cost incurred in different expenditure on the construction of a house. The total expenditure is ₹31,50,000.

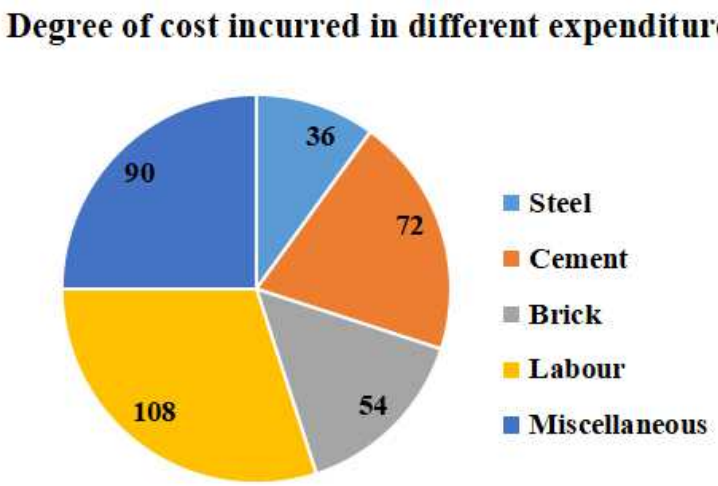

What is the percentage of expenditure on cement?

A 30%

B 25%

C 15%

D 20%

Answer: D

68. A marks her goods 25% above the cost price. She sells 25% of the goods at the marked price, 60% at 25% discount and the remaining at 10% discount. What is her overall gain or loss per cent?

Downloaded from cracku.in

A Gain 15.124%

B Loss 18.175%

C Loss 3.125%

D Gain 4.375%

Answer: D

69. **Working together A, B and C can complete a piece of work in 3 days. A completes the same work in 24 days and B completes it in 6 days. How many days will C alone take to complete the same work?**

A 18

B 8

C 12

D 6

Answer: B

1500+ Very Important Free SSC Solved Questions

70. **A man covers $\frac{5}{12}$ of a total journey by train, $\frac{7}{18}$ of the journey by bus and the remaining 7 km on foot. His total journey (in km) is:**

A 36 km

B 35 km

C 32 km

D 40 km

Answer: A

71. **If $3\cos\theta = 2\sin^2\theta, 0^\circ < \theta < 90^\circ$, then what is the value of $(tan^2\theta + sec^2\theta - cosec^2\theta)$?**

A $\frac{17}{3}$

B $-\frac{7}{3}$

C $-\frac{17}{3}$

D $\frac{7}{3}$

Answer: A

Downloaded from cracku.in

72. Study the graph which shows the target and actual production of ACs,(in thousands) of a factory over five months and answer the question that follows.

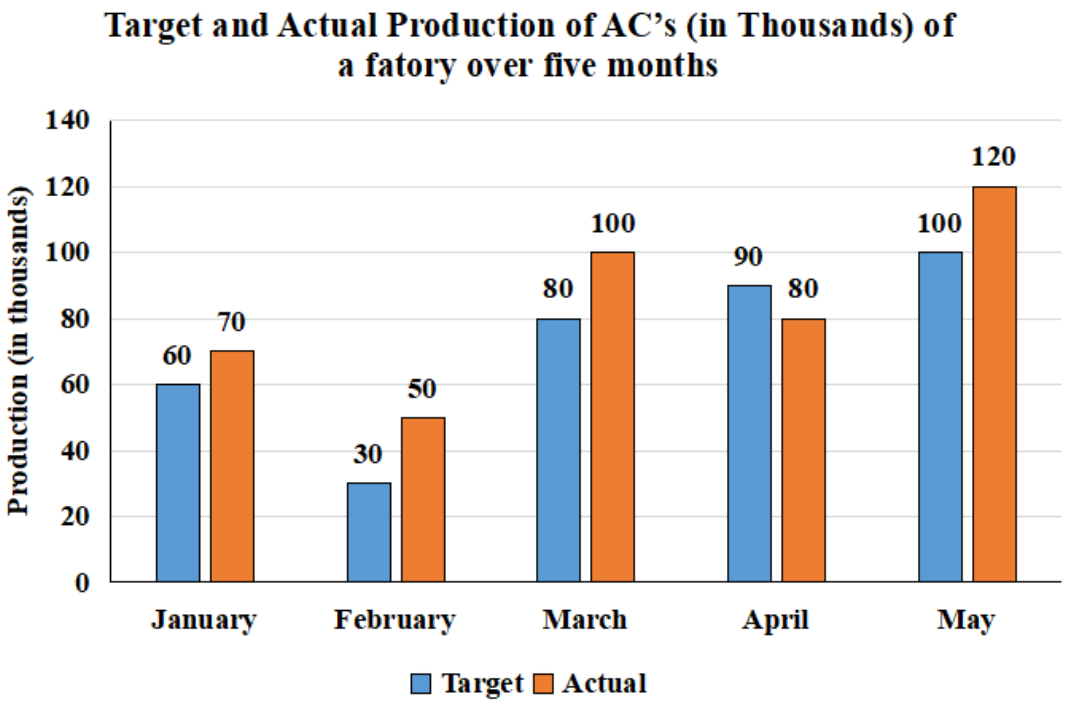

The total target production of ACs in February, March, April and May is what percent less than the total actual production of ACs over five months? (correct to one decimal place)

A 27.9%

B 26.8%

C 29.7%

D 28.6%

Answer: D

SSC Exam Update Videos & Free Study Material (YouTube Channel)

73. The volume of a rightcircular cone is 462 cm^3. Ifits heightis 12 cm, then thearea ofits base (in cm^2) is:

A 124.5

B 103.5

C 115.5

D 98.5

Answer: C

74. What is the ratio of the mean proportional between 1.2 and 10.8 to the third proportional to 0.2 and 1.2?

A 1 : 3

B 1 : 2

C 2 : 1

Downloaded from cracku.in

D 3 : 1

Answer: B

75. **If** $a + b + c = 11 and$**ab + bc + ca = 15**$, then what is the value of$**a^3 + b^3 + c^3 - 3abc $$?**

A 368

B 836

C 386

D 638

Answer: B

Latest Job Updates on Telegram - Join here

General Awareness

76. **Who among the following rulers belonged to the Tuluva dynasty?**

A Pushyamitra Sunga

B Vishnuvardhana

C Simha Vishnu

D Krishnadeva Raya

Answer: D

Join SSC Daily Quiz Telegram Group

77. **Where was the first hot air balloon wildlife safari launched in India in December 2020?**

A Palamu Tiger Reserve

B Ranthambore Tiger Reserve

C Bandhavgarh Tiger Reserve

D Pilibhit Tiger Reserve

Answer: C

78. **Which of the following quantities is measured using a torsion balance?**

A Magnetism

B Charge

C Pressure

D Force

Answer: D

Downloaded from cracku.in

79. **Who among the following cricketers won the Sir Garfield Sobers Award for 'ICC Male Cricketer of the Decade' in December 2020?**

A Steve Smith

B Mahendra Singh Dhoni

C Virat Kohli

D Rashid Khan

Answer: C

80. **Who among the following were awarded the Nobel Prize in Chemistry 2020 for their exemplary work in genome editing?**

A Jennifer A Doudna and Emmanuelle Charpentier

B George P Smith and Sir Gregory P Winter

C Gerard Mourou and Donna Strickland

D James P Allison and Tasuku Honjo

Answer: A

81. **Which of the following crops is grown throughout the year in the southern states of India?**

A Sorghum

B Maize

C Finger millet

D Rice

Answer: D

82. **Who among the following travellers came to India from Uzbekistan in the 11th century?**

A Abdur Razzaq Samarquandi

B Francois Bernier

C Ibn Battuta

D Al-Biruni

Answer: D

SSC CHSL Free Mock Test

83. **Which of the following states was NOT formed in the year 2000?**

A Jharkhand

B Telangana

C Uttarakhand

Downloaded from cracku.in

D Chhattisgarh

Answer: B

84. **Which of the following songs do the peasants of Rajasthan sing while working in fields?**

A Pankhida

B Pandavani

C Chhakri

D Barhamasa

Answer: A

85. **The total population per net cultivated area of a country refers to its _____.**

A physiological density

B population density

C agricultural density

D livestock density

Answer: A

SSC CHSL Prevoius Papers (DOWNLOAD PDF)

86. **Who among the following won a bronze medal at the World Athletics Championship in Paris in 2003?**

A Krishna Poonia

B Seema Punia

C PT Usha

D Anju Bobby George

Answer: D

87. **Which of the following soils is found in areas of heavy rainfall and high humidity?**

A Saline soil

B Peaty soil

C Red soil

D Yellow soil

Answer: B

88. **An ambassador of which of the following countries was elected as the President of the United Nations Human Rights Council in January 2021?**

A Cuba

Downloaded from cracku.in

B Libya

C Fiji

D Ghana

Answer: C

SSC CGL Previous Papers (DOWNLOAD PDF)

89. **In which of the following states is the Shatrunjaya Hills located?**

A Gujarat

B Andhra Pradesh

C Madhya Pradesh

D Karnataka

Answer: A

90. **In which of the following years did the Reserve Bank of India liberalise the licensing policy for Urban Co-operative Banks?**

A 1993

B 1998

C 1995

D 2001

Answer: A

91. **The _____ is a three or four letter abbreviation that signifies the file type.**

A extension

B search

C Virus

D name

Answer: A

SSC CGL Free Mock Test (Latest Pattern)

92. **Which of the following books did the famous cricketer Sunil Gavaskar author?**

A Democracy’s XI: The Great Indian Cricket Story

B Runs 'n Ruins

C Playing It My Way

D Captain Cool

Answer: B

Downloaded from cracku.in

93. **As per Union Budget 2020, the Government of India intends to double the country's milk processing capacity by the year _____.**

A 2028

B 2023

C 2030

D 2025

Answer: D

94. **Which of the following ports is used to connect a computer to a wired network?**

A Universal serial bus port

B Ethernet port

C Parallel port

D Super-video port

Answer: B

SSC CHSL Important Questions and Answers (Download PDF)

95. **Which of the following is a vector-borne disease?**

A Pneumonia

B Malaria

C Mumps

D Cholera

Answer: B

96. **Which of the following states launched India's and South-Asia's first blockchain-enabled rooftop solar trading platform in December 2020?**

A Uttar Pradesh

B Gujarat

C Rajasthan

D Madhya Pradesh

Answer: A

97. **Who is the Governor of the state of Chhattisgarh as of May 2020?**

A Bhupesh Baghel

B Anusuiya Uikey

C Phagu Chauhan

Downloaded from cracku.in

D Ramesh Bais

Answer: B

SSC CHSL Study Material

98. **Which of the following cells is NOT used in watches?**

A Silver oxide cell

B Mercury cell

C Zinc air cell

D Lead acid cell

Answer: D

99. **Where is the Rumi Darwaza located?**

A Lucknow

B Gwalior

C Agra

D Bhopal

Answer: A

100. **In December 2020, the Chief Minister of _____ announced that India's biggest hockey stadium is being set up in the state.**

A Telangana

B Odisha

C West Bengal

D Andhra Pradesh

Answer: B

SSC CHSL Free App

SSC CHSL Free Mock Test

SSC CHSL Prevoius Papers (DOWNLOAD PDF)

SSC CGL Previous Papers (DOWNLOAD PDF)

SSC CGL Free Mock Test (Latest Pattern)

Downloaded from cracku.in

SSC CHSL Important Questions and Answers (Download PDF)

SSC CHSL Study Material

SSC CHSL Free App

Daily Free SSC Practice Set

Free SSC Study Material (18,000 Solved Questions)

1500+ Very Important Free SSC Solved Questions

SSC Exam Update Videos & Free Study Material (YouTube Channel)

Latest Job Updates on Telegram - Join here

Join SSC Daily Quiz Telegram Group

Downloaded from cracku.in